FG	I can add by making 10.	15.11.21
	I used this to help me: D ML N C NL £	S I P

1 a) Use the number line to complete the calculations.

16 + 1 = ☐ 16 + 4 = ☐

16 + 2 = ☐ 16 + 5 = ☐

16 + 3 = ☐ 16 + 6 = ☐

b) Work out 16 + 7

16 + 7 = ☐

Talk to a partner about how you did it.

2 Use number bonds to complete the additions.

The first one has been done for you.

a)

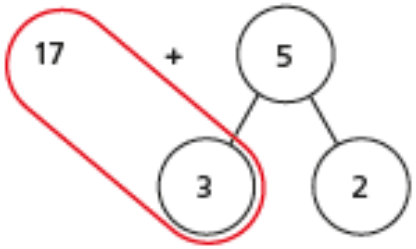

20 + 2 = 22

b)

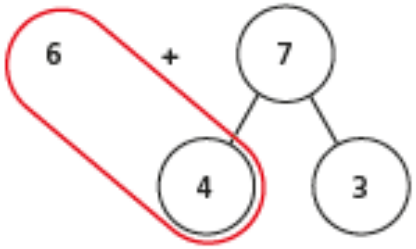

10 + 3 = ☐

c)

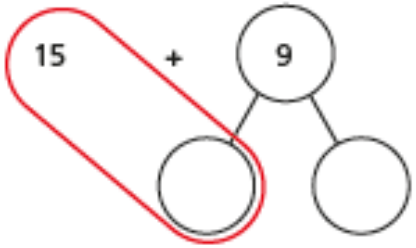

☐ + ☐ = ☐